Identifying and Naming 2D Shapes

Name: _____ Date: _____

Part A: Name each shape



1. _____



2. _____



3. _____

4. _____



5. _____



6. _____

Part B: Match the properties to the correct shape

7. A shape with 4 equal sides and 4 right angles: _____

8. A shape with 3 sides and 3 vertices: _____

9. A shape with 6 sides and 6 vertices: _____

10. A shape with no straight sides or vertices: _____

11. A shape with 5 sides and 5 vertices: _____

Part C: True or False

12. All quadrilaterals have exactly 4 sides. _____

13. A pentagon has more sides than a hexagon. _____

14. A circle has infinite lines of symmetry. _____

15. A rectangle is a type of quadrilateral. _____

Part D: Short answer

16. Name two different types of triangles: _____ and _____

17. What is the difference between a square and a rectangle?

_____